Sheet (2)
D.C. Motor

① $P_{out} = 3.37\,kW$, $N_m = 1725\,rpm$, $V_a = 125\,V$, shunt, $\eta = 0.825$ at full load Req: ① P_{in} ② I_{Line} ③ T_{out}

Solution

$$\eta = \frac{P_{o/p}}{P_{i/p}} * 100 \quad \therefore 0.825 = \frac{3.37}{P_{in}}$$

$$\therefore \boxed{P_{in} = 4.084\,kW} \#$$

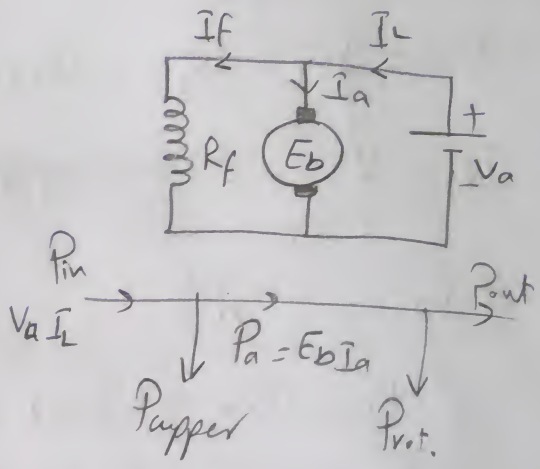

$$P_{in} = V_a \cdot I_L$$

$$\therefore I_L = \frac{4084.848}{125} = \boxed{32.678\,A} \#$$

$$T_{out} = \frac{P_{out}}{\omega_m} = \frac{3.37 * 10^3}{(\frac{\pi * 1725}{30})} = \boxed{18.655\,N.m} \#$$

② $V_a = 250\,V$, $R_a = 0.06\,\Omega$, $I_{a1} = 25\,A \rightarrow N_{m1} = 850\,rpm$, Series $I_{a2} = 18\,A$ Req: N_{m2} for $V_{a2} = V_{a1}$, $R_{se.} = 0.025\,\Omega$

Solution

$$E_{b1} = V_{a1} - I_{a1}(R_a + R_{se.})$$
$$= 250 - 25(0.06 + 0.025)$$
$$\therefore \boxed{E_{b1} = 247.875\,V}$$

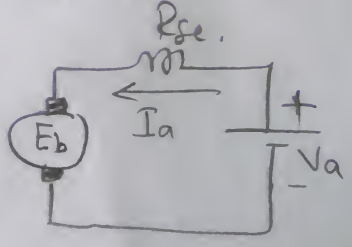

$$E_{b2} = V_{a2} - I_{a2}(R_a + R_{se.})$$
$$= 250 - 18(0.06 + 0.025)$$
$$\therefore \boxed{E_{b2} = 248.47\,V}$$

$\because E_b \propto I_f \omega_m \Rightarrow$ for series motor $E_b \propto I_a \omega_m$

$$\therefore \frac{E_{b1}}{E_{b2}} = \frac{I_{a1} \cdot N_{m1}}{I_{a2} \cdot N_{m2}} \quad \therefore N_{m2} = \frac{I_{a1} E_{b2}}{I_{a2} E_{b1}}$$

$$\therefore \boxed{N_{m2} = 1183.389\,rpm} \#$$

) $R_a = 0.1\,\Omega$, $N_{m1} = 1000$ rpm, $250 = V_{a1}$ Shunt Motor, $R_{sh1} = 25$

$P_{i/p} = 6.5$ kW, if $V_{a2} = 230$ V, $R_{sh2} = 125\,\Omega$

Req: N_{m2} to keep T_L = Cost.

Solution

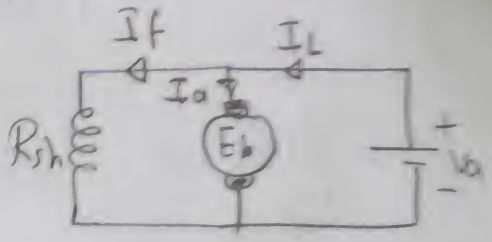

at $V_{a1} = 250$ V

$I_{a1} = I_{L1} - I_{f1}$, $I_{L1} = \frac{P_{i/p}}{V_{a1}} = 26A$

$I_{f1} = \frac{V_{a1}}{R_{sh1}} = \frac{250}{250} = 1A$

$\therefore \boxed{I_{a1} = 25A}$

$\therefore E_{b1} = 250 - 25 * 0.1 = 247.5$ V

for Keeping T_L Const. , $T \propto I_f I_a$

$\therefore \frac{T_{L1}}{T_{L2}} = \frac{I_{a1} I_{f1}}{I_{a2} I_{f2}} = 1$

, $I_{f2} = \frac{V_{a2}}{R_{sh2}} = \frac{230}{125} = 1.84$ A

$\therefore I_{a2} = I_{a1} \frac{I_{f1}}{I_{f2}} = \boxed{13.587A}$

$\therefore E_{b2} = 230 - 13.587 * 0.1 = \boxed{228.6413\text{ V}}$

$\because E_b \propto I_f \omega_m$

$\therefore N_{m2} = N_{m1} * \frac{E_{b2} I_{f1}}{E_{b1} I_{f2}}$

$\therefore \boxed{N_{m2} = 502\text{ rpm}}$

السرعة ملتنجي اكهربتل وتيار لجال زاد

ries motor, $R_a = 0.1\Omega$, $R_{se.} = 0.05\Omega$, $V_a = 600V$, $I_{a_1} = 150A$, $N_{m_1} = 3000 rpm$, $N_{m_2} = 2000 rpm$, Req. Radd series with armature

To keep T_L const.

Solution

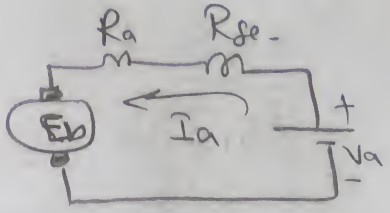

$$E_{b_1} = V_{a_1} - I_{a_1}(R_a + R_{se.})$$

$$\therefore E_{b_1} = 600 - 150(0.1 + 0.05)$$

$$\therefore \boxed{E_{b_1} = 577.5V}$$

for T_L const. , $\because T_L \propto I_a^2$ in series motor

$$\therefore I_{a_1} = I_{a_2}$$

$$\therefore \frac{E_{b_1}}{E_{b_2}} = \frac{N_{m_1}}{N_{m_2}} \quad \therefore E_{b_2} = E_{b_1}\frac{N_{m_2}}{N_{m_1}}$$

$$\therefore \boxed{E_{b_2} = 385\ V}$$

$$E_{b_2} = V_a - I_{a_2}(R_{add} + R_a + R_{se.})$$

$$\therefore 385 = 600 - 150(R_{add} + 0.15)$$

$$\therefore 215 = 150(R_{add} + 0.15)$$

$$\therefore R_{add} + 0.15 = 1.433$$

$$\therefore \boxed{R_{add} = 0.98\Omega} \#$$

(5) Series $R_a = 0.1\Omega$, $R_{fe.} = 0.1\Omega$, $N_m = 400$ rpm, $P_{in} = 60$ KW at $V_{a_1} =$ if $V_{a_2} \longrightarrow 400$ V, $R_{ins.} = 2.5$, $T_{L_2} = \frac{1}{2} T_{L_1}$ find $N_{m_2} = ?$

Solutions

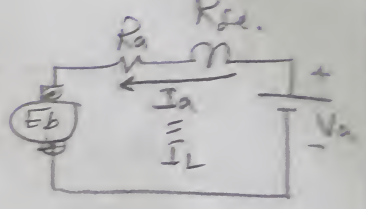

$P_{in} = V_a \cdot I_L \therefore I_{L_1} = I_{a_1} = \frac{P_{in}}{V_{a_1}} = \frac{60000}{500} = 120A$

$E_{b_1} = V_{a_1} - I_{a_1}(R_a + R_{fe.})$

$\therefore E_{b_1} = 500 - 120 * 0.2$

$\therefore \boxed{E_{b_1} = 476\ V}$

$\because$ Rinserted $\therefore$ flux $\downarrow\downarrow$ $\therefore I_a \downarrow\downarrow$

$\because T \propto I_a^2 \therefore \frac{T_{L_1}}{T_{L_2}} = \frac{I_{a_1}^2}{I_{a_2}^2}$, $T_{L_2} = \frac{1}{2} T_{L_1}$

$\therefore \frac{1}{\frac{1}{2}} = \frac{I_{a_1}^2}{I_{a_2}^2} \therefore I_{a_2} = \sqrt{\frac{120^2}{2}} = \boxed{84.85A}$

$\therefore E_{b_2} = V_{a_2} - I_{a_2}(R_a + R_{fe.} + R_{ins})$

$\therefore E_{b_2} = 400 - 84.85(0.2 + 2.5)$

$\therefore \boxed{E_{b_2} = 170.905\ V}$

$\therefore N_{m_2} = N_{m_1} \frac{E_{b_2} I_{a_1}}{E_{b_1} I_{a_2}}$

$\therefore \boxed{N_{m_2} = 203.1127\ \text{rpm}}$ #

$= 250\,V$, $R_{sh_1} = 250\,\Omega$, $R_a = 0.25\,\Omega$, $N_{m_1} = 1500\,rpm$, $I_{a_1} = 20\,A$
if $R_{sh_2} = 500\,\Omega$ $T_{L_1} = T_{L_2}$ Req: ① $N_{m_2} = ?$ ② $I_{a_2} = ?$

Solutions

$E_{b_1} = V_{a_1} - I_{a_1} R_a = 250 - 20 * 0.25$

$\therefore \boxed{E_{b_1} = 245\,V}$

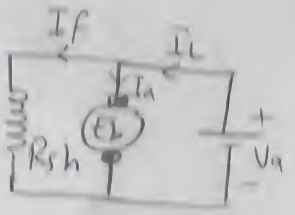

$I_{f_1} = \frac{250}{250} = 1\,A$

$I_{f_2} = \frac{250}{500} = 0.5\,A$

$\because T_{L_1} = T_{L_2} \quad \therefore \frac{T_{L_1}}{T_{L_2}} = \frac{I_{f_1} \cdot I_{a_1}}{I_{f_2} \cdot I_{a_2}} \quad \therefore I_{a_2} = I_{a_1} \frac{I_{f_1}}{I_{f_2}} = \frac{1 * 20}{0.5}$

$\therefore \boxed{I_{a_2} = 40\,A}$

$\therefore E_{b_2} = V_a - I_{a_2} R_a = 250 - 40 * 0.25$

$\therefore \boxed{E_{b_2} = 240\,V} \quad \therefore N_{m_2} = N_{m_1} * \frac{E_{b_2}}{E_{b_1}} \frac{I_{f_1}}{I_{f_2}} = \boxed{2938.77\ rpm}$

---

⑦ $R_a = 0.1\,\Omega$, $R_{sh} = 400\,\Omega$, $V_a = 200\,V$ shunt, $I_{L_1} = 10\,A$, $P_{rot.} = 100\,W$
$N_m = 400\,rpm$ Req: ① P_a ② P_{out} ③ η ④ T_{out}

Solutions

$I_{f_1} = \frac{V_{a_1}}{R_{sh}} = \frac{200}{400} = 0.5\,A$

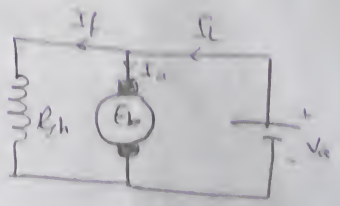

$\therefore I_{a_1} = 9.5\,A \quad \therefore E_{b_1} = 200 - 9.5 * 0.1 = 199.05\,V$

$\therefore P_a = E_{b_1} I_{a_1} = \boxed{1.891\,kw}$

$P_{in} = V_{a_1} I_{L_1} = 2\,kw$

$\therefore P_{out} = P_a - P_{rot} = 1.891 - 0.1 = \boxed{1.791\,kw}$

$\therefore \boxed{\eta = 89.55\%}$

$T_{out} = \frac{P_{out}}{\omega_m} = \frac{1.791 * 10^3}{(\pi * \frac{400}{30})} = \boxed{42.756\,N.m}$

→ if $\phi_2 = \frac{1}{2}\phi_1 \quad \therefore I_{f_2} = \frac{1}{2} I_{f_1}$, $I_{a_2} = I_{a_1}$, $V_{a_2} = V_{a_1}$

$\therefore E_{b_2} = E_{b_1} = 199.05\,V$

$\therefore \frac{E_{b_1}}{E_{b_2}} = \frac{I_{f_1} N_{m_1}}{I_{f_2} N_{m_2}} \quad \therefore 1 = \frac{2 N_{m_1}}{N_{m_2}} \quad \therefore N_{m_2} = 2 N_{m_1}$ #

⑦ $\therefore \boxed{N_{m_2} = 800\,rpm}$

if $T_{L2} = 2T_{L1}$, $V_{a2} = V_{a1}$, $N_{m2} = ?$ (7)

$\therefore T \propto I_f I_a \quad \therefore \frac{T_{L1}}{T_{L2}} = \frac{I_{f1} I_{a1}}{I_{f2} I_{a2}}$

→ Consider I_f const.

$\therefore \frac{1}{2} = \frac{I_{a1}}{I_{a2}} \quad \therefore I_{a2} = 2 I_{a1}$

$\boxed{I_{a2} = 19\,A}$

$\therefore E_{b2} = 200 - 19 * 0.1 = 198.1\,V$

$\therefore \frac{E_{b1}}{E_{b2}} = \frac{N_{m1}}{N_{m2}} \quad \therefore N_{m2} = N_{m1} \frac{E_{b2}}{E_{b1}}$

$\therefore N_{m2} = 400 * \frac{198.1}{199.05} = 398.1\,rpm$

---

(8) $P = 2$, $N_m = 707\,rpm$, $I_L = 100A$, $V_a = 85\,V$ series , $R_{se} = 0.03\,\Omega$

$R_a = 0.04\,\Omega$ if become shunt $T_{L2} = T_{L1}$ → $N_{m2} = ?$

$E_{b1} = V_a - I_{a1}(R_a + R_{se}) = 85 - 100 * (0.03 + 0.04)$

$\therefore E_{b1} = 78\,V$

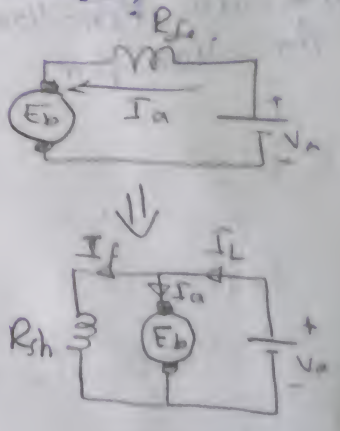

∴ 2 poles, $N_{m_1} = 707$ rpm, $I_{L_1} = 100A$, $V_a = 85V$ with field coils in series (Two Coils), $R_{se.} = 0.03\Omega$, $R_a = 0.04\Omega$

→ if field coils are parallel ∴ $(R_{se.} = \frac{0.03}{2} = 0.015\Omega)$, $T_{L_1} = T_{L_2}$

Req: ① $N_{m_2} = ?$

② $R_{add} = ?$ to make speed = 707 rpm

Solution

When the two field coils are connected in series ∴ $R_{set} = 0.03 + 0.03 = 0.06\Omega$

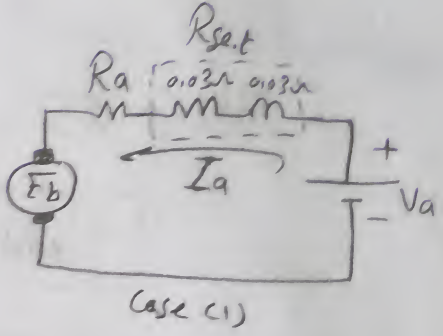

Case (1)

∴ $E_{b_1} = V_a - I_{a_1}(R_a + \overrightarrow{R_{set}})$ (→ series), $I_{L_1} = I_{a_1}$

∴ $E_{b_1} = 85 - 100 * (0.04 + 0.06)$

∴ $\boxed{E_{b_1} = 75V}$

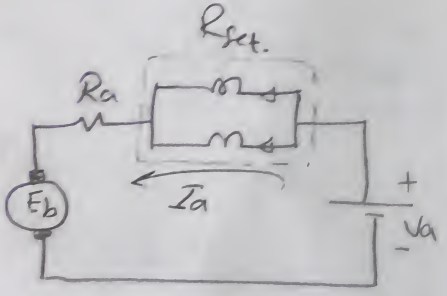

When the two field coils are connected in parallel ∴ $R_{set.(shunt)} = \frac{0.03}{2} = 0.015\Omega$

the torque is constant

∴ $T \alpha I_a^2$ (series) ∴ $\frac{T_1}{T_2} = \frac{I_{a_1}^2}{I_{a_2}^2}$ ∴ $I_{a_1} = I_{a_2} = 100A$

(العزم ثابت) أيضاً التيار لازال ثابتاً

رغم توصيل ملفات توازي لأن التيار سوف يتوزع عليهم ويتجمع مرة أخرى

∴ $E_{b_2} = V_a - I_{a_2}(R_a + \overrightarrow{R_{set.}})$ (→ shunt)

∴ $E_{b_2} = 85 - 100 * (0.04 + 0.015) = \boxed{79.5V}$

$\phi = NI$

(تتغير بتغير الملفات) (ثابت لأن التيار ثابت)

∴ $E \alpha I_f w_m$ ∴ $\frac{E_{b_1}}{E_{b_2}} = \frac{I_{a_1} N_{m_1}}{I_{a_2} N_{m_2}}$ ∴ $N_{m_2} = N_{m_1} \frac{E_{b_2}}{E_{b_1}}$

∴ $\boxed{N_{m_2} = 749.42 \text{ rpm}}$

R_{add} = ? to restore N_m = 707 rpm ?

$\because N_{m2} = 749.42$ rpm $\longrightarrow E_{b2} = 79.5$ V

$\therefore E_b = V_a - I_a (R_a + R_{set}) \longrightarrow$ 707 rpm

(E_b → 75 V; R_{set} → shunt)

$\therefore 75 = 85 - 100 * (0.04 + R_{add} + 0.015)$

$\therefore \boxed{R_{add} = 0.045\ \Omega}$

ies, $V_a = 440\ V$, $R_a + R_{se} = 0.3\ \Omega$

$R = 0\ \Omega$

$I_{a1} = 20\ A$, $N_{m1} = 1200\ rpm$

at $R = 3\ \Omega$

$I_{a2} = 15\ A$ ① $N_{m2} = ?$ R_{eq1}

② if $\phi_1 = 8\ mwb$, find $P_a = E_a I_a$, $T_a = P_a . \omega_m$ in each case?

Solutions

at $R = 0\ \Omega$

$E_{b1} = V_a - I_{a1}(R_a + R_{se} + R)$, $R \to 0$

$\therefore E_{b1} = 440 - 20(0.3)$

$\therefore \boxed{E_{b1} = 434\ V}$

at $R = 3\ \Omega$

$E_{b2} = V_a - I_{a2}(R_a + R_{se} + R)$, $R \to 3$

$\therefore E_{b2} = 440 - 15(0.3 + 3)$

$\therefore \boxed{E_{b2} = 390.5\ V}$

$\because E_b \propto I_f \omega_m$ (series: $I_f = I_a$) $\therefore E_b \propto I_a \omega_m$

$\therefore \frac{E_{b1}}{E_{b2}} = \frac{I_{f1} N_{m1}}{I_{f2} N_{m2}}$

$\therefore \frac{434}{390.5} = \frac{20 * 1200}{15 * N_{m2}}$

$\therefore \boxed{N_{m2} = 1439.63\ rpm}$

$P_{a1} = E_{b1} . I_{a1}$

$\therefore \boxed{P_{a1} = 8680\ w}$

$\therefore T_{a1} = P_{a1} / \omega_{m1} = \boxed{69.07\ N.m}$

$P_{a2} = E_{b2} . I_{a2}$

$\therefore \boxed{P_{a2} = 5857.5\ w}$

$\therefore T_{a2} = P_{a2} / \omega_{m2} = \boxed{38.853\ N.m}$

(10) shunt , $N_{m_1} = 1200$ rpm , $V_a = 420$V , $I_{a_1} = 30$A , $R_{add} = ?$

$N_{m_2} = 600$ rpm , $I_{a_1} = I_{a_2}$, $R_a = 3\Omega$?

Solutions

$$E_{b_1} = V_a - I_{a_1} R_a = 420 - 30 * 3 = 330\text{V}$$

$\because E \propto I_f \omega_m$

I_f = Constant

بما أن طريقة التوصيل على التوالي مع مقاومة Armature إذن $\Rightarrow I_{f_1} = I_{f_2}$

$$\therefore \frac{E_{b1}}{E_{b2}} = \frac{N_{m1}}{N_{m2}} = \frac{1200}{600}$$

$$\therefore E_{b1} = 2\, E_{b2} \quad \therefore E_{b2} = \frac{1}{2} E_{b1} = 165\text{V}$$

$$\therefore \boxed{E_{b2} = 165\text{V}}$$

$$\because E_{b2} = V_a - I_{a_2} (R_a + R_{add})$$

$$\therefore 165 = 420 - 30(3 + R_{add})$$

$$8.5 = 3 + R_{add}$$

$$\therefore \boxed{R_{add} = 5.5\Omega}$$